Name:



What Number am I?

What is the number shown by the 10 strips and 1 cubes?

1.

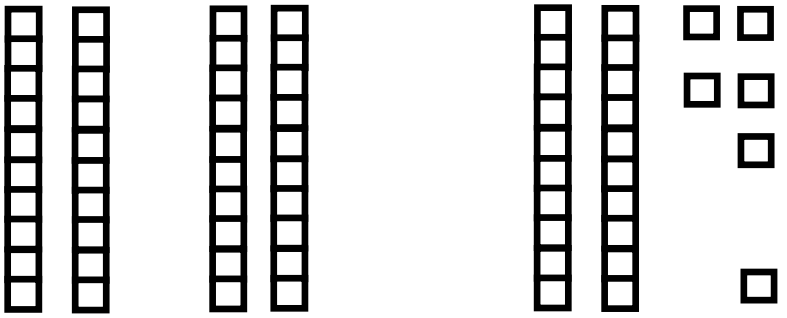

2.



3.



4.