

Name:

Perimeter of L-Shapes

Find the perimeter of the L-Shapes. Answer using the correct units.

1.

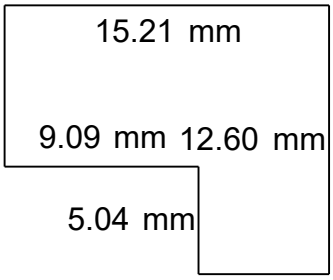

2.

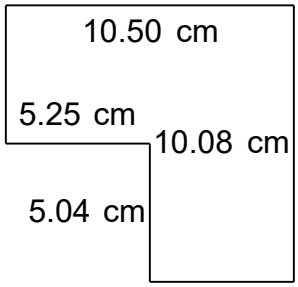

3.

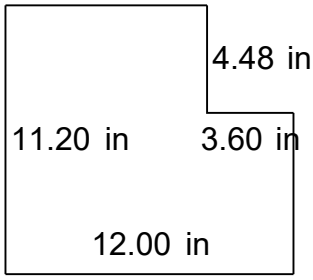

4.

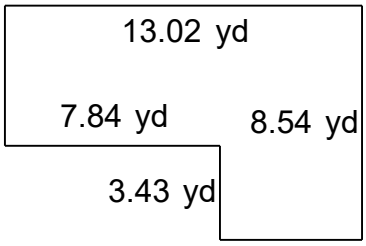

5.

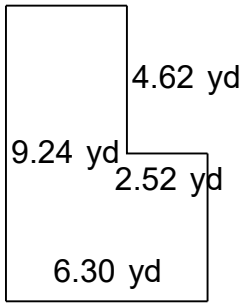

6.

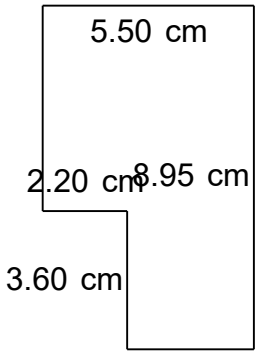

7.

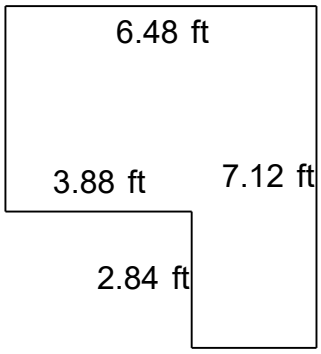

8.

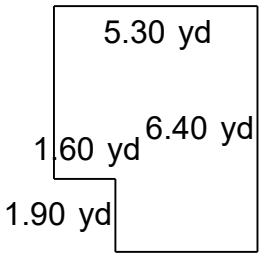

9.

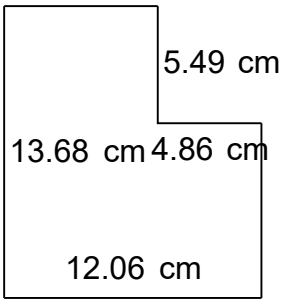

10.

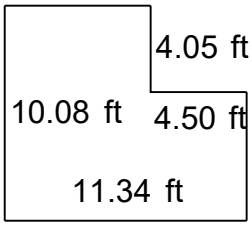

© https://worksheetplace.com

Score: /10

Name:

Perimeter of L-Shapes

Find the perimeter of the L-Shapes. Answer using the correct units.

1.

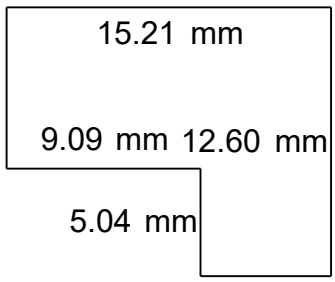

P = 55.62 mm

2.

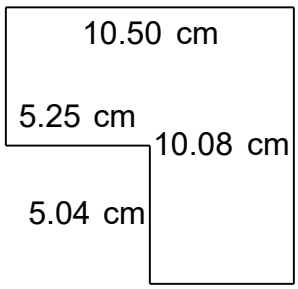

P = 41.16 cm

3.

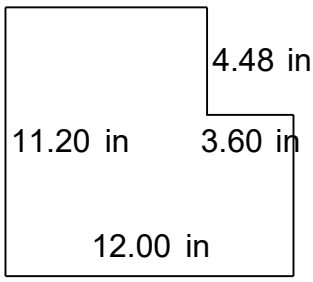

P = 46.40 in

4.

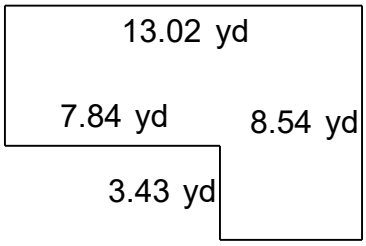

P = 43.12 yd

5.

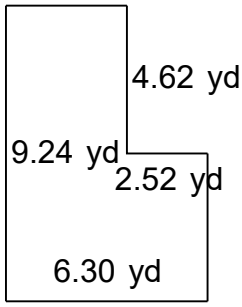

P = 31.08 yd

6.

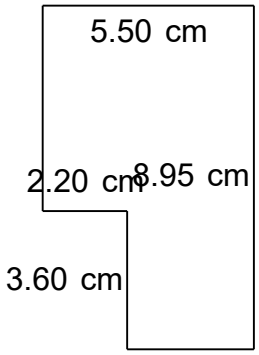

P = 28.90 cm

7.

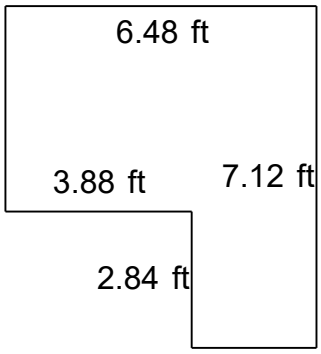

P = 27.20 ft

8.

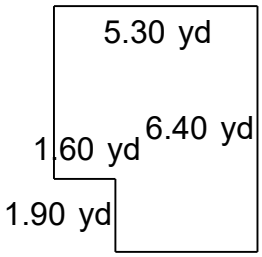

P = 23.40 yd

9.

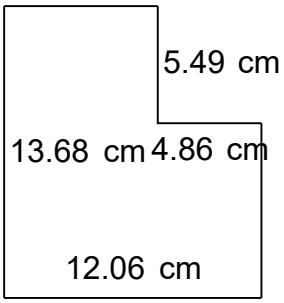

P = 51.48 cm

10.

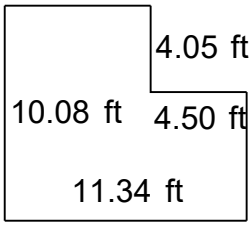

P = 42.84 ft

© https://worksheetplace.com

Score: /10