Name:

What Time Was It?

Look at the time and draw the time to show what time it was:

1.



What time was it 3 hours 30 minutes ago?

2.



What time was it 1 hour 30 minutes ago?

3.



What time was it 1 hour 0 minutes ago?

4.



What time was it 3 hours 30 minutes ago?

5.



What time was it 2 hours 30 minutes ago?

6.



What time was it 5 hours 30 minutes ago?

7.



What time was it 1 hour 30 minutes ago?

8.



What time was it 3 hours 0 minutes ago?