Name:



How Many are Needed?

Circle or **color** how many 10 strips and 1 cubes are needed to make the number?

1. 

32

2. 

49

3. 

23

4. 

18

© https://worksheetplace.com Image: https://scrappindoodles.ca